Name _____

1. How many edges does the shape have?

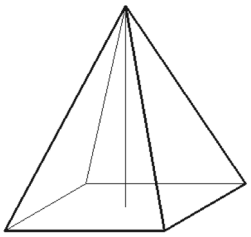

2. How many faces does the shape have?

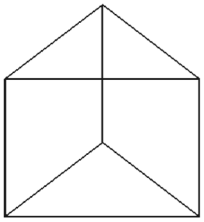

3. How many vertices does the shape have?

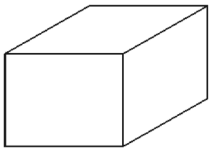

4. How many faces does the shape have?

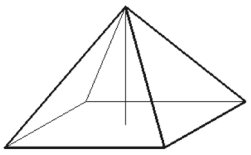

5. How many edges does the shape have?

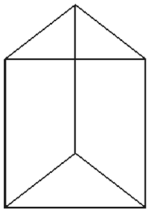

© 2026 Mathsbox Ltd

Name _____

1. How many edges does the shape have?

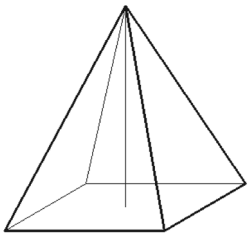

8

2. How many faces does the shape have?

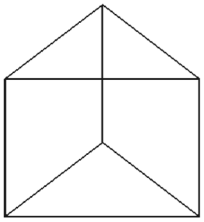

5

3. How many vertices does the shape have?

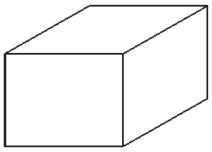

8

4. How many faces does the shape have?

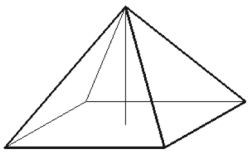

5

5. How many edges does the shape have?

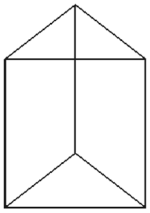

9

© 2026 Mathsbox Ltd